DECENAS

© Copyright WEBDELMAESTRO.COM

NOMBRE: _____ FECHA: _____

Colorea, repasa y completa.

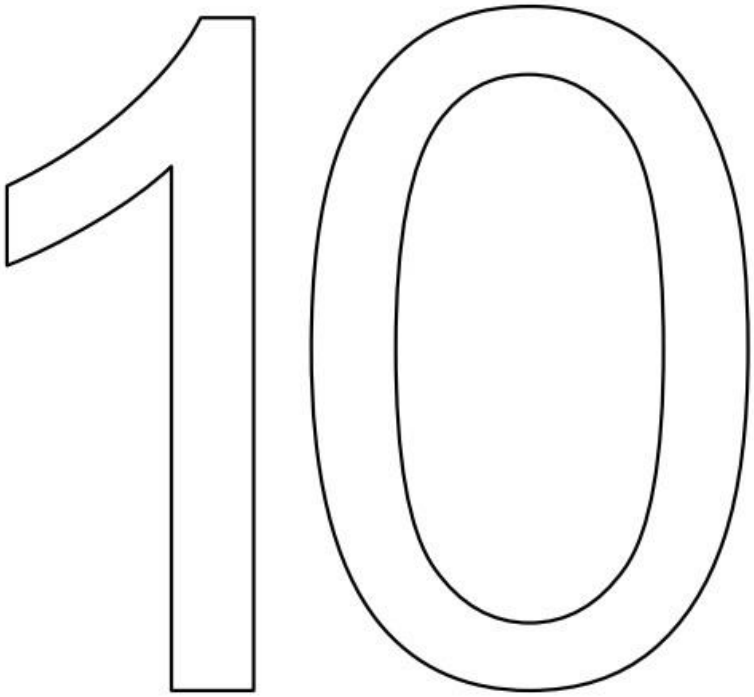

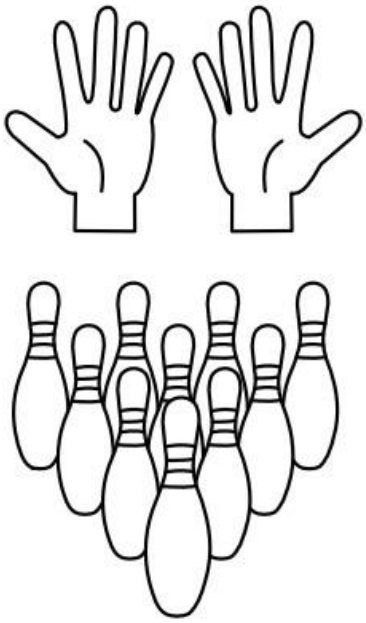



10 10 10 10 10 10 10 10

10 - - - -

- - - -

- - - -

10

1 decena son 10 unidades.

© Copyright WEBDELMAESTRO.COM

NOMBRE: _____ FECHA: _____



2 decenas son 20 unidades.



3 decenas son 30 unidades.

Suma y resta decenas.

60	+	30	=	90					70	−	20	=							
80	−	20	=						60	+	40	=							
90	+	10	=						40	−	20	=							
90	−	40	=						50	+	50	=							
30	+	10	=						60	−	50	=							
60	−	40	=						70	+	30	=							
20	+	50	=						90	−	60	=							
80	−	60	=						50	+	20	=							
10	+	70	=						80	−	10	=							

Completa la serie.

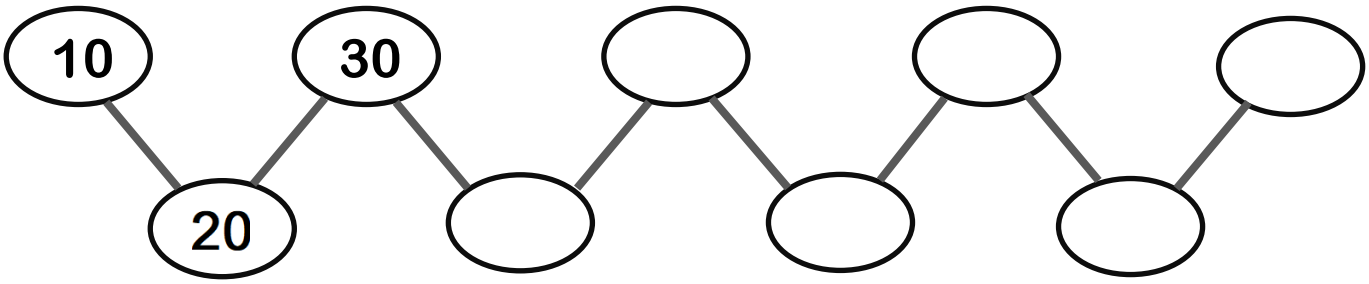

© Copyright WEBDELMAESTRO.COM

NOMBRE: _____ **FECHA:** _____

1 decena de cerezas



Suma y resta.

30 + 30 + 20 – 40 – 20

50 – 40 + 60 – 20 + 30

40 + 30 – 60 + 20 + 60

60 + 20 – 30 – 40 + 70

80 – 40 + 60 – 20 – 50

Completa con decenas

♥ + ♥ – ♥ + ♥ – ♥ = 60

© Copyright WEBDELMAESTRO.COM

NOMBRE: _____ FECHA: _____

Completa la noria de las decenas. Empieza a resolver por el centro en la dirección de las flechas.

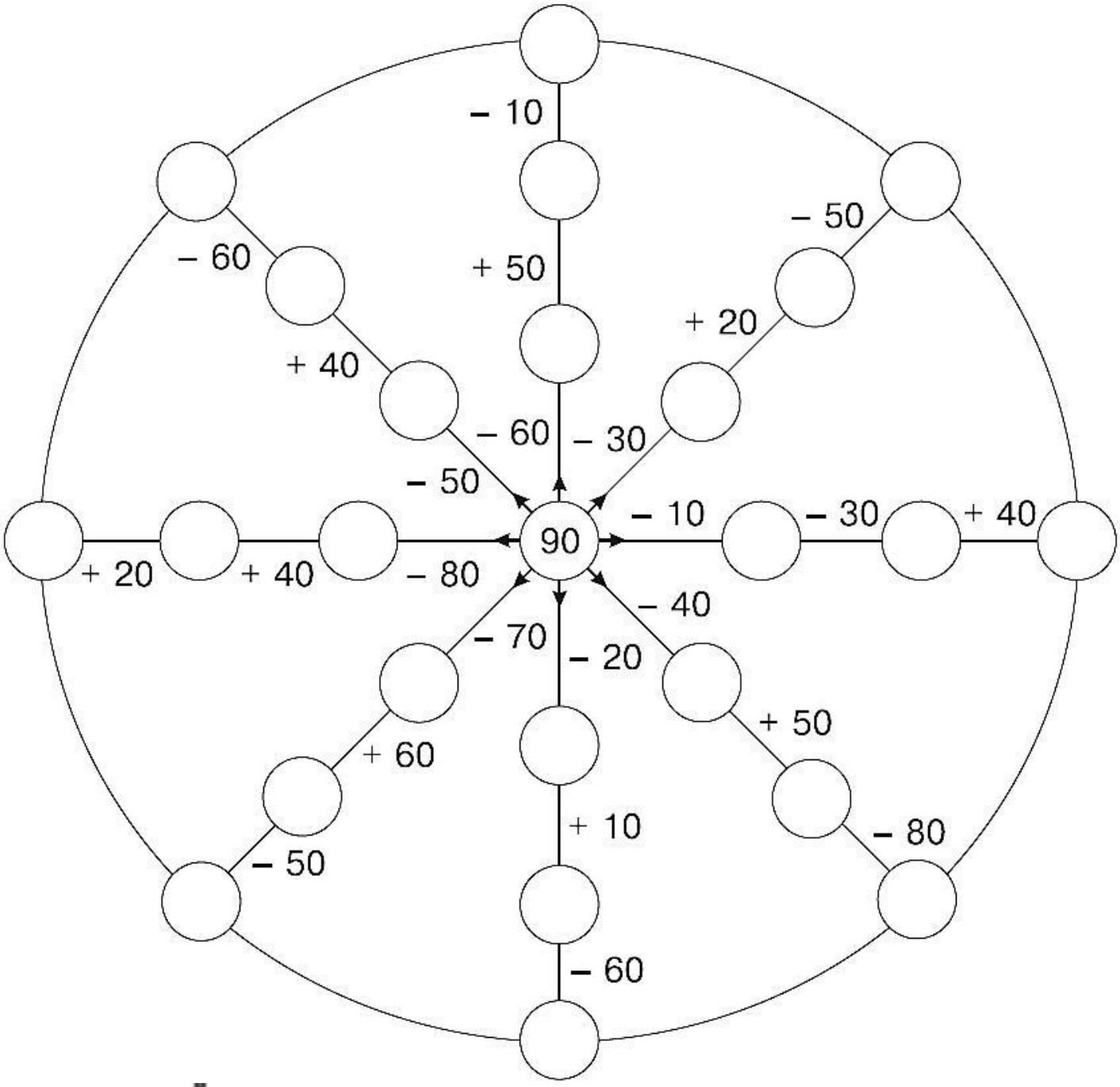



© Copyright WEBDELMAESTRO.COM

NOMBRE: _____ FECHA: _____

Completa la serie.

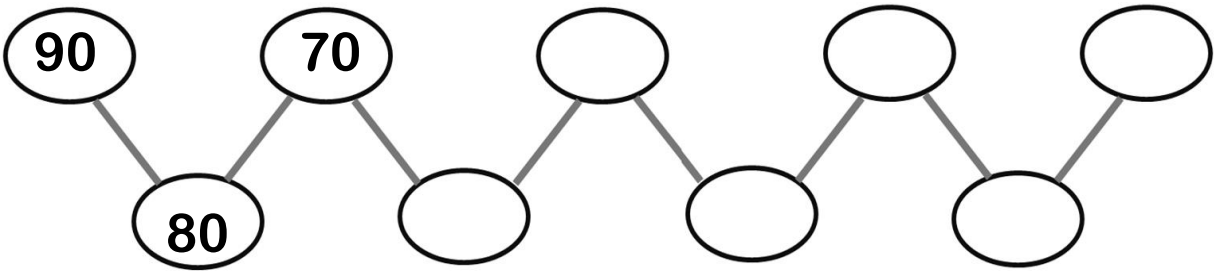

Completa.

14 = ☐ decenas ☐ unidades

18 = ☐ decenas ☐ unidades

20 = ☐ decenas ☐ unidades

1 decena 1 unidad = ☐

1 decena 7 unidades = ☐

1 decena 9 unidades = ☐

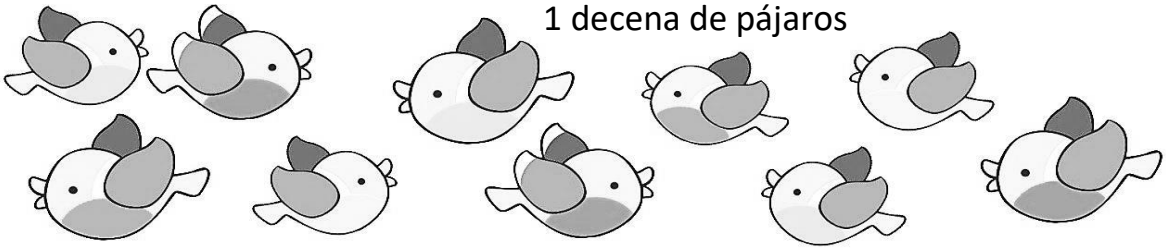

Une cada operación con la decena correspondiente.

60 + 20	**90**	70 – 10
90 – 30	**80**	80 – 30
50 + 40	**60**	20 + 20
30 – 10	**40**	100 – 80
40 + 60	**50**	30 + 50
70 – 30	**20**	70 + 30
10 + 40	**100**	80 + 10

© Copyright WEBDELMAESTRO.COM

NOMBRE: _____ FECHA: _____

Suma.

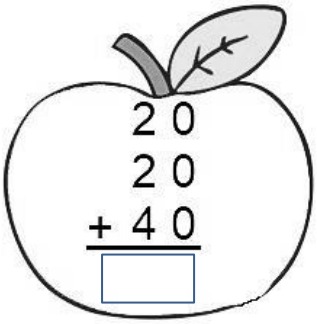

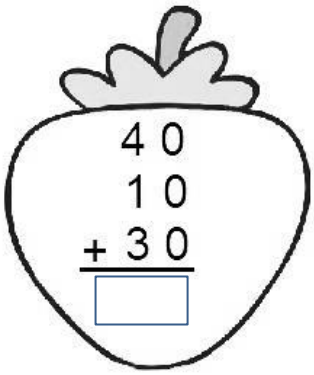

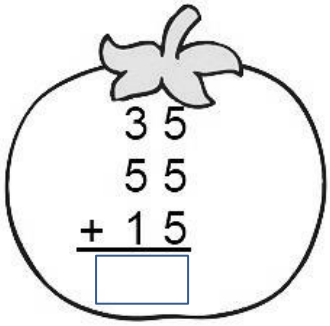

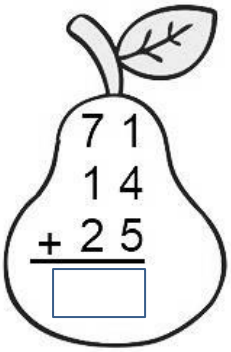

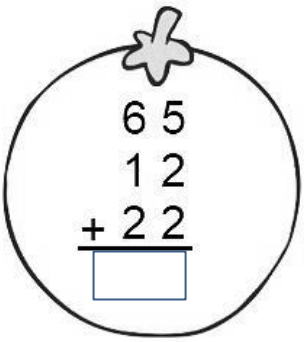









Descompón en unidades y decenas y resuelve.

49 + 20 = ☐ + 9 = ☐

☐ 9

58 – 4 = 50 + ☐ = ☐

50 ☐

54 – 30 = ☐ + 4 = ☐

☐ 4

73 + 6 = 70 + ☐ = ☐

70 ☐

36 + 40 = ☐ + ☐ = ☐

☐ ☐

91 + 8 = ☐ + ☐ = ☐

☐ ☐

© Copyright WEBDELMAESTRO.COM

NOMBRE: _____ FECHA: _____

Calcula y ordena las letras de los resultados de mayor a menor. Escribe debajo el mensaje.

10 —+ 20→ [ ] —+ 50→ [ ] —− 40→ [ ] —+ 10→ [ ] K

80 —− 70→ [ ] —+ 30→ [ ] —− 20→ [ ] —+ 80→ [ ] O

40 —+ 40→ [ ] —+ 10→ [ ] —− 30→ [ ] —− 50→ [ ] Y

100 —− 70→ [ ] —+ 30→ [ ] —+ 20→ [ ] —− 60→ [ ] E

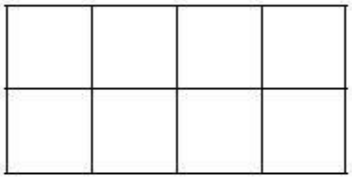



Completa.

treinta y uno	31	→	[ ]	decenas,	[ ]	unidades
setenta y seis	( )	→	[ ]	decenas,	[ ]	unidades
_____	64	→	[ ]	decenas,	[ ]	unidades
_____	( )	→	5	decenas,	8	unidades

© Copyright WEBDELMAESTRO.COM

NOMBRE: _____ FECHA: _____

Escribe el número.

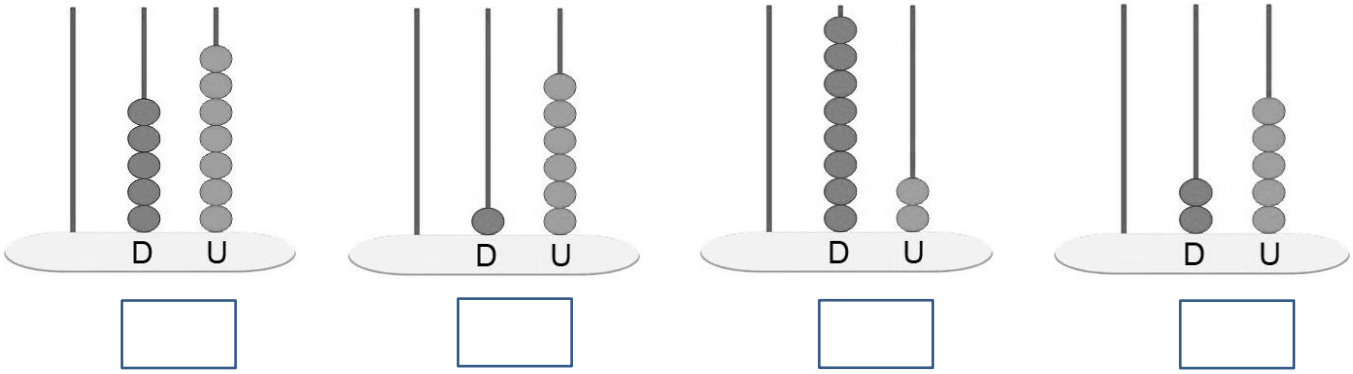

Une cada número con su pareja.

32	5 decenas y 4 unidades
18	3 decenas y 2 unidades
54	1 decena y 8 unidades
70	7 decenas y 0 unidades

Calcula mentalmente.

35 + ☐ = 40
42 + ☐ = 50
66 + ☐ = 70
24 + ☐ = 30

82 – ☐ = 80
37 – ☐ = 30
61 – ☐ = 60
24 – ☐ = 20

57 + ☐ = 60
79 – ☐ = 70
43 + ☐ = 50
96 – ☐ = 90

70 + 20 = ☐
80 – 60 = ☐
80 – 40 = ☐
20 + 50 = ☐
30 + 70 = ☐

46 + 3 = ☐
86 – 5 = ☐
94 + 4 = ☐
38 – 7 = ☐
41 + 6 = ☐

72 – 30 = ☐
86 + 10 = ☐
94 – 50 = ☐
61 – 50 = ☐
38 + 40 = ☐

© Copyright WEBDELMAESTRO.COM

NOMBRE: _____ FECHA: _____

Completa.

3 7	→	30	unidades	+	7	unidades
4 9	→	40	unidades	+		
2 4	→			+		
9 2	→			+		

Colorea las unidades de azul y las decenas de rojo.

D U	D U	D U	D U	D U	D U
8 7	5 4	3 6	4 1	2 3	4 4

Suma.

18	41	60	98	33	75
+ 51	+ 48	+ 29	+ 1	+ 65	+ 24

23	14	72	89	36	55
+ 76	+ 74	+ 16	+ 10	+ 42	+ 21

© Copyright WEBDELMAESTRO.COM

NOMBRE: _____ FECHA: _____

Resuelve comenzando por la flecha.

46		76	−	25	=				96	−		=	24
+		−									−		+
23	+		=						98	−		=	46
=		=		+		−			−		=		=
		33			+	24	=						
				=		=			=				
54	+		=	99		24				+		=	57
−		−									+		−
22		12	+	48	=					−		=	
=		=		−		−			−		=		=
						48			25		50		34
				=		+			=				
86	−	55	=			26				+	44	=	
−		+				=					+		−
65	+	14	=						78	−		=	52
=		=									=		=
	+		=			98				−		=	
				+		−			−				
70	−	45	=			22			52	+		=	90
−		+		=		−			=		−		−
	+	42	=			35				+	14	=	
=		=				=					=		=
			−		=					−		=	
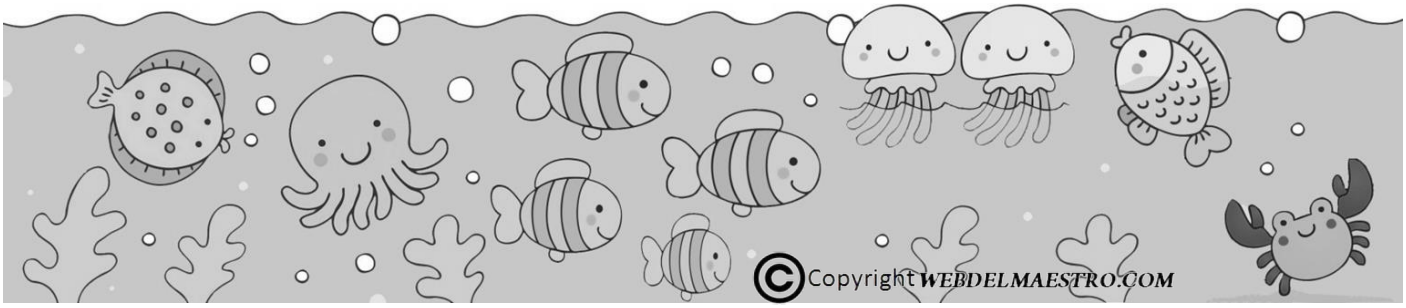
1 decena de animales marinos